Je sais faire

2 **Écris** la fraction correspondant à chaque portion de puzzle.



3 **Écris** la fraction correspondant à chaque portion de la figure.



4 **Reproduis** et **colorie** un quart de la figure.

a.



b.



8 **Écris** la fraction correspondant à la portion coloriée, puis à celle non coloriée.

a.

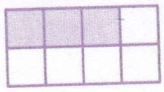

b.



c.

d.



9 **Écris** la fraction correspondant à la portion coloriée.

a.

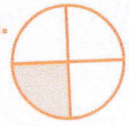

b.

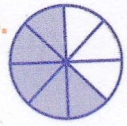

c.



d.