Lexidata : **Groupe 44** **Série 1**

Combien y a-t-il d'arbres sur chaque ligne ?

1.	4	2	3
2.	6	5	4
3.	7	9	8
4.	3	2	1
5. 	11	12	10
6. 	8	9	7
7. 	8	11	9
8.	3	2	4
9. 	3	4	5
10. 	7	6	9
11. 	12	10	11
12. 	6	5	4

© Helgé 2023 sur helgeblog.eklablog.com