Prénom : _____

MATHEMATIQUES

1. Colorie la partie demandée de chacune de ces figures et simplifie, si possible, la fraction:

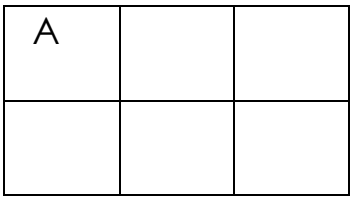

$\frac{2}{6} = \frac{....}{....}$

$\frac{1}{4} = \frac{....}{....}$

$\frac{1}{4} = \frac{....}{....}$

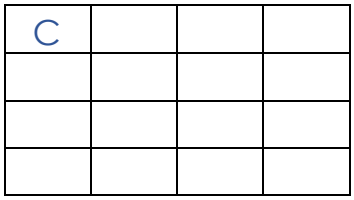

$\frac{2}{8} = \frac{....}{....}$

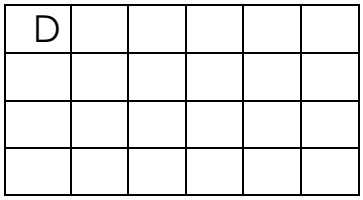

$\frac{2}{3} = \frac{....}{....}$

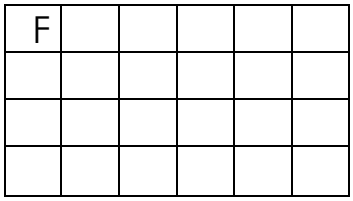

$\frac{5}{6} = \frac{....}{....}$

$\frac{2}{8} = \frac{....}{....}$

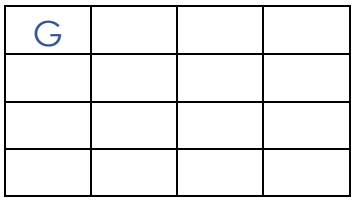

$\frac{8}{20} = \frac{....}{....}$

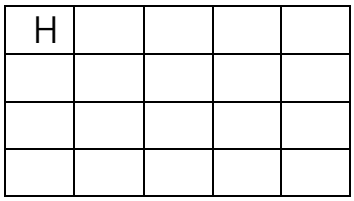

$\frac{2}{6} = \frac{....}{....}$

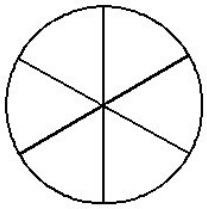

$\frac{8}{10} = \frac{....}{....}$

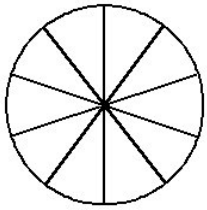

$\frac{3}{8} = \frac{....}{....}$

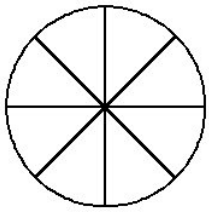

$\frac{1}{4} = \frac{....}{....}$

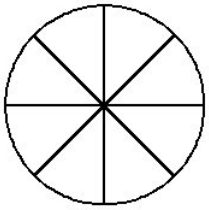

$\frac{1}{2} = \frac{....}{....}$

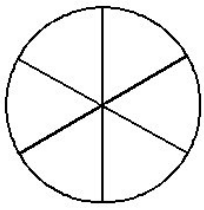

$\frac{9}{12} = \frac{....}{....}$

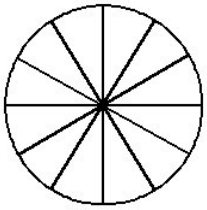

2. Écris la valeur décimale et donne le nom de chaque fraction :

$\frac{1}{3}$ = ... on l'appelle : .....

$\frac{1}{4}$ = ... on l'appelle : .....

$\frac{1}{2}$ = ... on l'appelle : .....

$\frac{2}{3}$ = ... on l'appelle : .....

3. Écris les fractions en chiffres.

cinq tiers : .....

sept neuvièmes : .....

quatorze centièmes : .....

soixante dixièmes : .....

cinq quart : .....

quinze demi : .....

4. A quelle lettre correspond chaque fraction ?

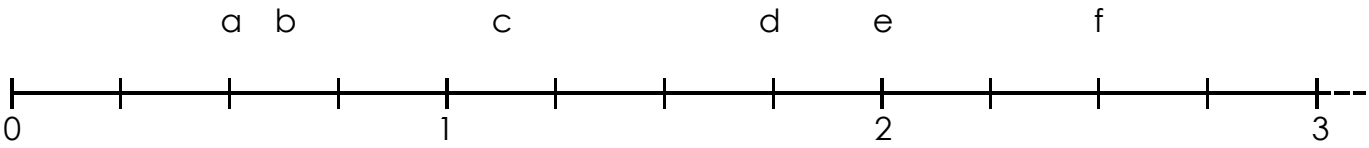

$\frac{10}{4}$ ..... $\frac{1}{2}$ ..... $\frac{9}{8}$ ..... $\frac{2}{3}$ ..... $\frac{7}{4}$ .....