Exercices LES FRACTIONS EQUIVALENTES

Exercice n°1

Imprime, colorie et écris les fractions équivalentes sur la fiche puis colle-la dans ton cahier jaune.
Si tu ne peux pas imprimer, écris simplement les fractions équivalentes sur ton cahier jaune.

Colorez le deuxième modèle de la même façon que le premier ensuite déterminez les fractions équivalentes.

1. 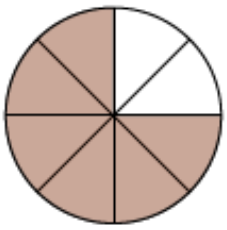 = 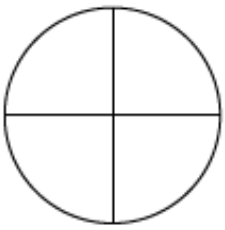 — = —

2. 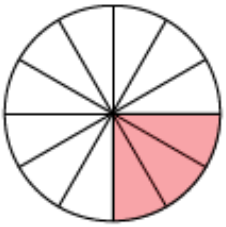 = 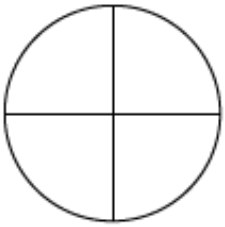 — = —

3. 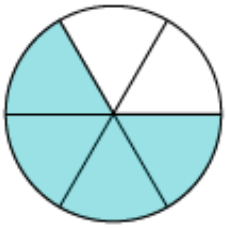 = 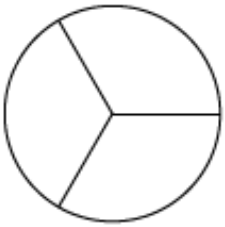 — = —

4. 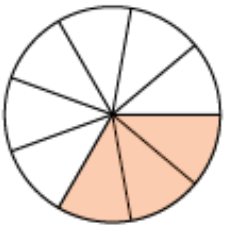 = 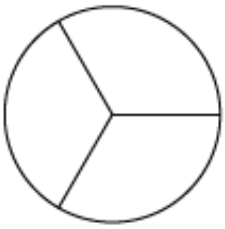 — = —

5. 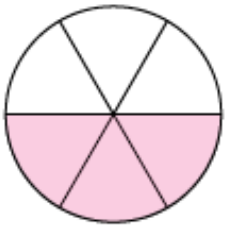 = 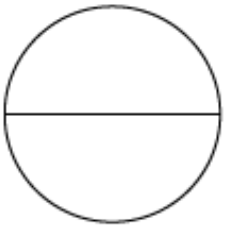 — = —

Exercice n°2

$\frac{\square}{5} = \frac{6}{10}$ $\quad \frac{2}{\square} = \frac{4}{8}$ $\quad \frac{1}{2} = \frac{5}{\square}$ $\quad \frac{2}{11} = \frac{\square}{33}$

$\frac{\square}{11} = \frac{36}{44}$ $\quad \frac{\square}{3} = \frac{5}{15}$ $\quad \frac{1}{2} = \frac{3}{\square}$ $\quad \frac{\square}{5} = \frac{2}{10}$