Commutativité de l'addition

Observe les images et écris un calcul qui correspond: les pulls

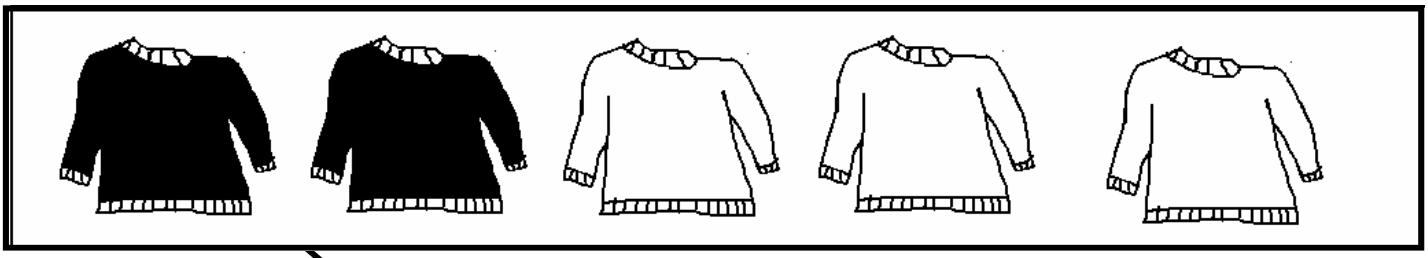

… + … = …

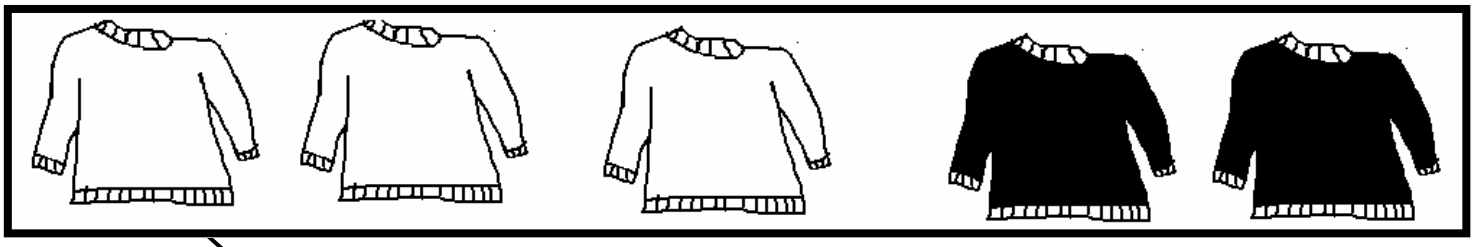

… + … = …

Observe les images et écris un calcul qui correspond: les papillons

… + … = …



… + … = …

Fais le dessin qui correspond à l'autre opération

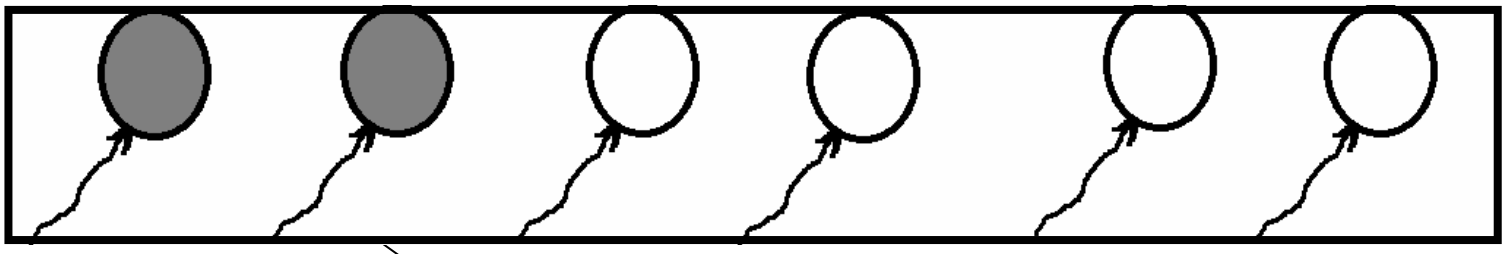

2 + 4 = 6

4 + 2 = 6

2 + 4 = 6

↓

4 + 2 = 6

Écris le calcul inversé. Exemple:

5+ 3= 8

↓

… + … = ...

2 + 6 = 8

↓

… + … = ...

1 + 4 = 5

↓

… + … = ...

3 + 7 = 10

↓

… + … = ...

2 + 1 = 3

↓

… + … = ...

4 + 3 = 7

↓

… + … = ...