1. ***CALCUL MENTAL – table de 2***

2. ***Trace les rectangles suivants***

2 x 7 2 X 9 8 X 2 6 X 2 4 X 2

3. ***Colorie de la même couleur les étiquettes de même valeur.***

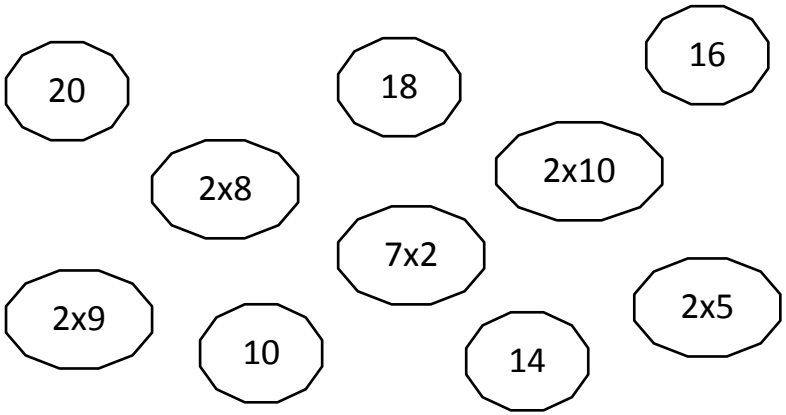

Nombre de réponses justes

Je sais utiliser la table de 2

OUI
MOYEN
NON

http://le-stylo-de-vero.eklablog.com

1. ***CALCUL MENTAL – table de 5***

2. ***Les enfants ont laissé l'empreinte de leurs mains dans la sable. Calcule chaque fois le nombre de doigts.***

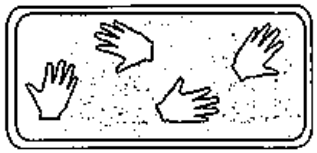

5 × ..... = ...

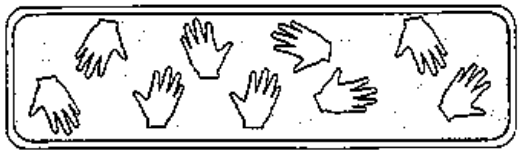

5 × ..... = ...

5 × ..... = ...

5 × ..... = ...

3. ***Calcule le nombre de points de chaque joueurs***

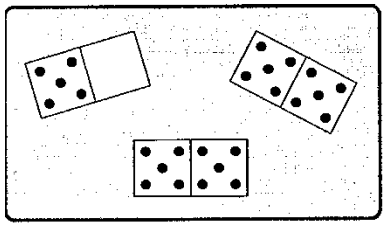

5 × ..... = ...



5 × ..... = ...

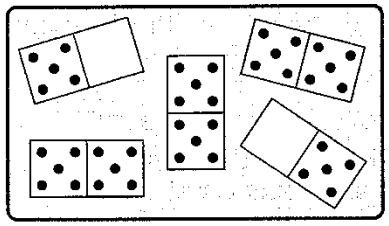

5 × ..... = ...



5 × ..... = ...

Nombre de réponses justes

Je sais utiliser la table de 5

OUI
MOYEN
NON

http://le-stylo-de-vero.eklablog.com